Improper and Mixed Fractions Visual

Name:

Write each amount as a mixed number.

1) 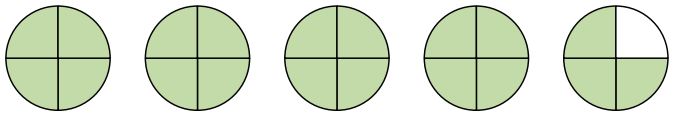

2) 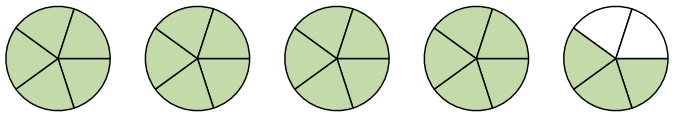

3) 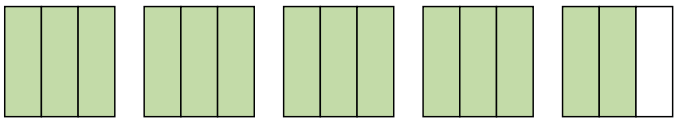

4) 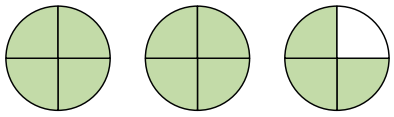

5) 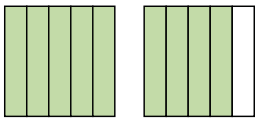

Write each amount as an improper fraction.

6) 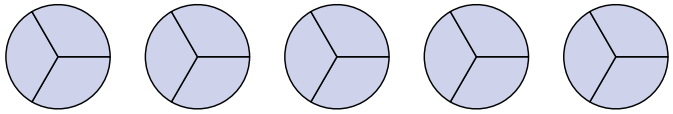

7) 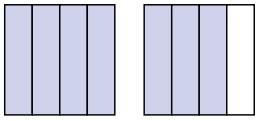

8) 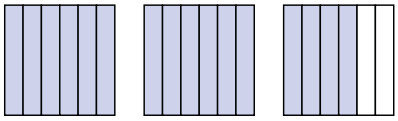

9) 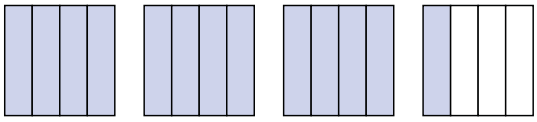

10) 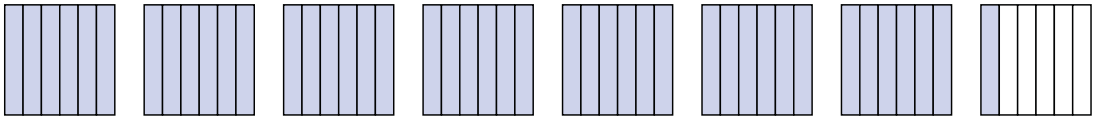

11) 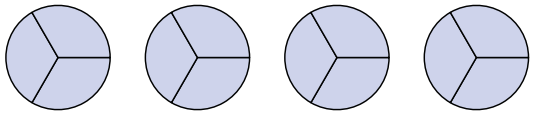

Answers

1. _____
2. _____
3. _____
4. _____
5. _____
6. _____
7. _____
8. _____
9. _____
10. _____
11. _____

1-10	91	82	73	64	55	45	36	27	18	9
11	0									

Improper and Mixed Fractions Visual

Name: **Answer Key**

Write each amount as a mixed number.

1) 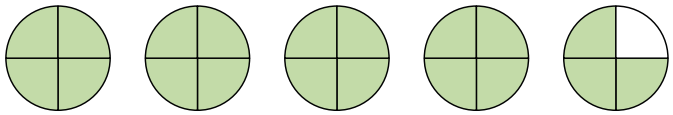

2) 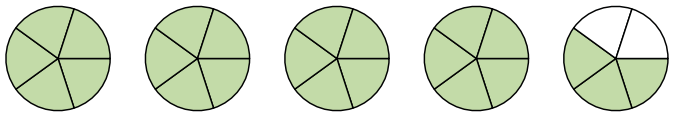

3) 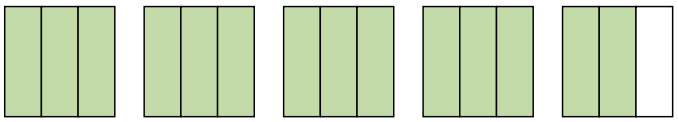

4) 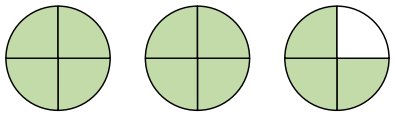

5) 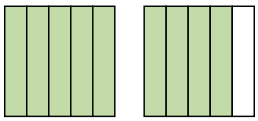

Write each amount as an improper fraction.

6) 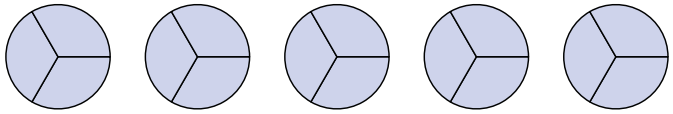

7) 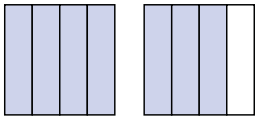

8) 

9) 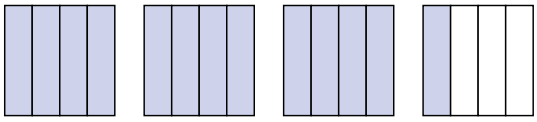

10) 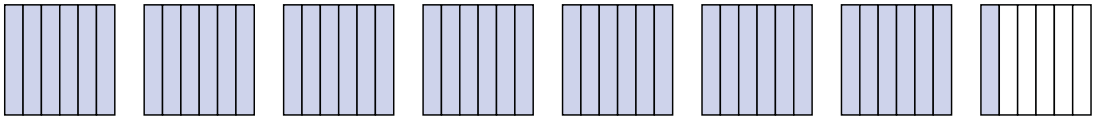

11) 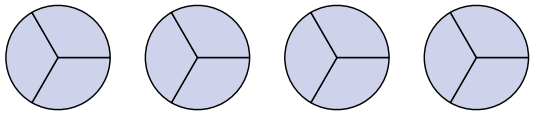

Answers

1. $4\frac{3}{4}$
2. $4\frac{3}{5}$
3. $4\frac{2}{3}$
4. $2\frac{3}{4}$
5. $1\frac{4}{5}$
6. $\frac{15}{3}$
7. $\frac{7}{4}$
8. $\frac{16}{6}$
9. $\frac{13}{4}$
10. $\frac{43}{6}$
11. $\frac{12}{3}$

1-10	91	82	73	64	55	45	36	27	18	9
11	0									